 Name .....

Multiplying and dividing

Write a multiplication and a division for each set of cubes.

1. 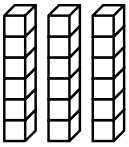

3 × 6 = 18

18 ÷ 6 = 3

2. 

☐ × ☐ = ☐

☐ ÷ ☐ = ☐

3. 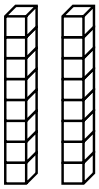

☐ × ☐ = ☐

☐ ÷ ☐ = ☐

4. 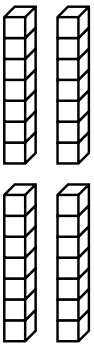

☐ × ☐ = ☐

☐ ÷ ☐ = ☐

5. 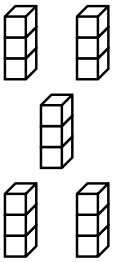

☐ × ☐ = ☐

☐ ÷ ☐ = ☐

6. 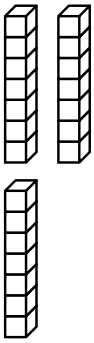

☐ × ☐ = ☐

☐ ÷ ☐ = ☐

7. 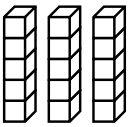

☐ × ☐ = ☐

☐ ÷ ☐ = ☐

I can make connections between multiplication and division

Heinemann Active Maths First Level Exploring Number PPM © Pearson Education Limited 2010