Dividing with a Numberline

Name:

Use the numberline to solve each problem.

1) 10 ÷ 5 =

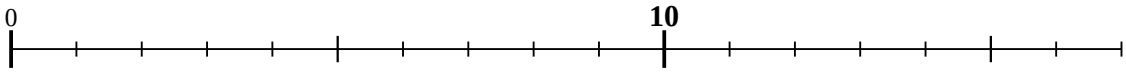

2) 4 ÷ 2 =



3) 24 ÷ 6 =

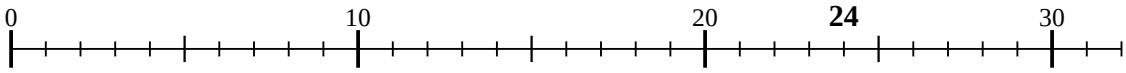

4) 16 ÷ 8 =

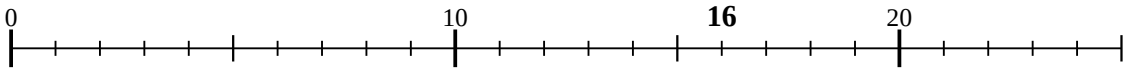

5) 45 ÷ 9 =

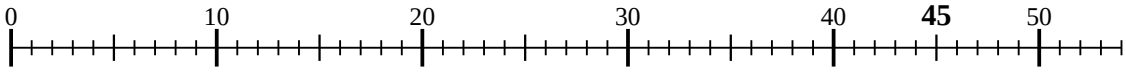

6) 15 ÷ 3 =

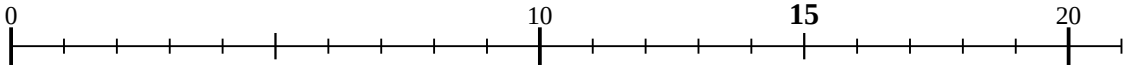

7) 12 ÷ 4 =

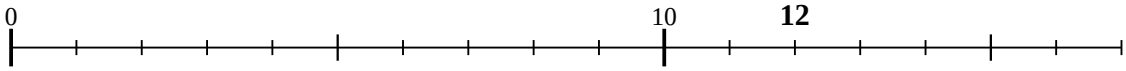

8) 40 ÷ 8 =

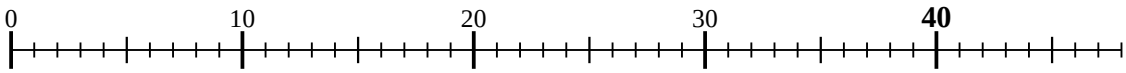

9) 9 ÷ 3 =

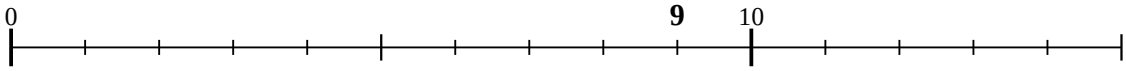

10) 20 ÷ 5 =

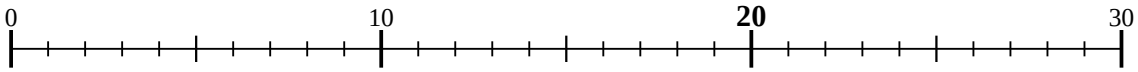

11) 12 ÷ 3 =

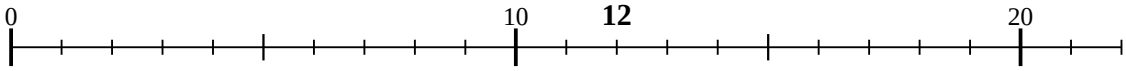

Answers

1. _____
2. _____
3. _____
4. _____
5. _____
6. _____
7. _____
8. _____
9. _____
10. _____
11. _____

1-10	91	82	73	64	55	45	36	27	18	9
11	0									