The 3 R's

Revisit - Review - Revise

1. What are the **names** given to these 2 dimensional shapes ?

a 

b 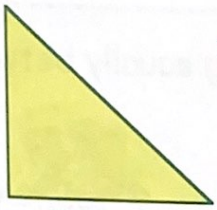

c 

d 

2. List what shapes are in the picture and **how many** of each there are.

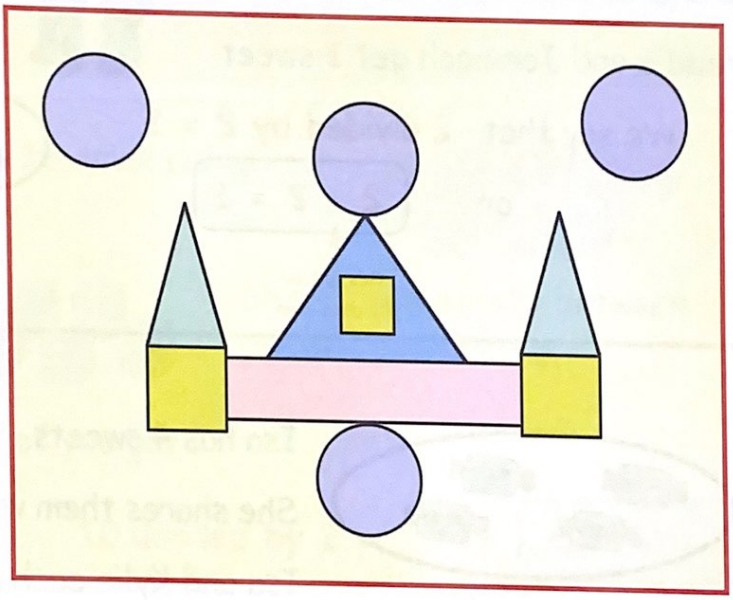

3. How many :-

a corners are in a square

b sides are in a rectangle

c angles are in a triangle

d sides are in a circle

e corners are in a rectangle

f angles are in a square

g sides are in a square

h corners are in a circle

i angles are in a rectangle

j sides are in a triangle

k angles are in a circle

l corners are in a triangle ?

4. Find **one difference** between :-

a a square and a rectangle
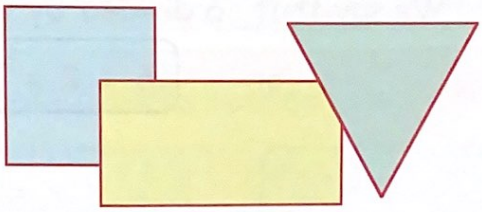
b a rectangle and a triangle.